桃園市龜山區壽山國民小學 109 學年度第一學期一年級數學領域期中評量試卷

一年　　班　　座號:　　姓名:

一、 數一數，有多少？畫出一樣多的◯，再寫數字： 每答 2 分，共 16 分

	畫◯	數字
① 		
② 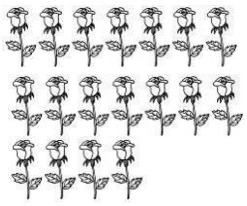		
③ 		
④ 		

二、 填填看： 每題 2 分，共 12 分

(1)

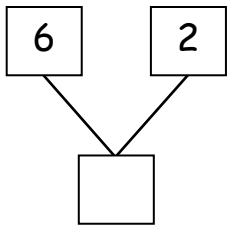

(2)

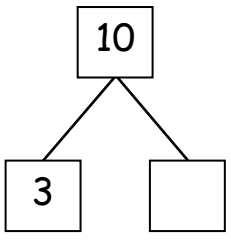

(3)

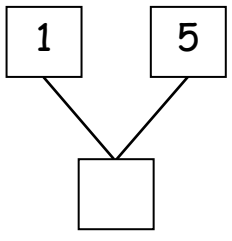

(4)

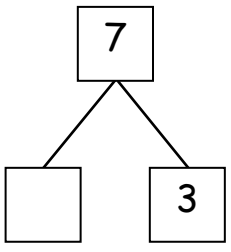

(5)

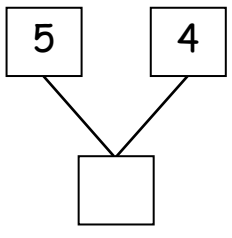

(6)

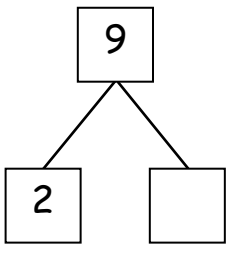

三、 看圖填填看： 每題 2 分，共 10 分



(1)從前面數起。

① 排在第（　　）個，

排在 前面 1 個的是第（　　）個。

② 數到，共有（　　）個人。

(2)從後面數起。

② 數到，共有（　　）個人。

②戴帽子的男生是第（　　）個。

四、 數一數，有多少？寫在(　　)中，並把比較多的在□中打 v：

一題 6 分，共 24 分

(1)



有（　　）隻



有（　　）隻

(2)

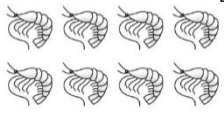

有（　　）隻



有（　　）隻

(3)



有（　　）枝



有（　　）朵

(4)

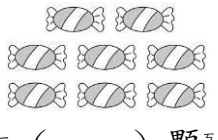

有（　　）顆

有（　　）枝

五、 依照指示塗上顏色：

每答 2 分， 共 4 分

第 6 個



8 個



六、 依照指示在□ 中打 V：

每題 2 分， 共 6 分

(1)哪一個比較長？

□

□

(2)哪一個比較高？

□ □

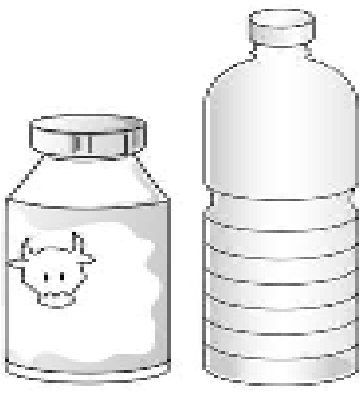

(3)哪一條是曲線？

□ 直線 □ 曲線

七、 畫○做做看，並圈出答案：

每答 2 分， 共 6 分

① 8 個 和 5 個 ，哪一種比較多？

(，)比較多

八、 填入正確的數字：

每格 2 分， 共 18 分

(1) 19 □ 17 16 □ 14 □ 12

(2) 6 8 10 □ □ □

(3) 30 □ 26 24 □ 20 □ 16

九、 多少和多少合起來是 10？

連連看： 每題 1 分， 共 4 分

①



ㄅ



②



ㄆ



③

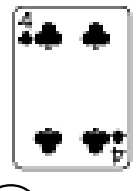

ㄇ



④



ㄈ